3 Augen sehen mehr als 6.

Welcher Schatten ist identisch?



Malscheune®
ANDREAS VON FRAJER



Lösung



Malscheune®
ANDREAS VON FRAJER